Name-

Date-

Green Group

Leaning Objective

To use the appropriate unit of measurement and language when measuring different objects.

Please find and measure the following objects, refer to the support sheets in order to help you choose the appropriate unit of measurement

How long is your pencil? (Please tick the appropriate unit of measurement and measuring device before answering the question).

Kilometre

Metre

Centimetre

Millimetre

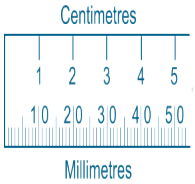

Capacity

Litre

millilitre

[redacted]

[redacted]

Name-

Date-

Green Group

Learning Objective

To use the appropriate unit of measurement and language when measuring different objects.

Please find and measure the following objects, refer to the support sheets in order to help you choose the appropriate unit of measurement

How heavy is your empty mug? (Please tick the appropriate unit of measurement and measuring device before answering the question).

Weight

Kilogram

gram

Capacity

Litre

millilitre

Name-

Date-

Green Group

Learning Objective

To use the appropriate unit of measurement and language when measuring different objects.

Please find and measure the following objects, refer to the support sheets in order to help you choose the appropriate unit of measurement

How high is your chair? (Please tick the appropriate unit of measurement and measuring device before answering the question).

Kilometre

Metre

Centimetre

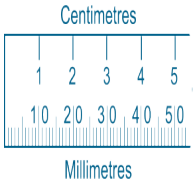

Millimetre

Capacity

Litre

millilitre

[redacted]

[redacted]

Name-

Date-

Green Group

Learning Objective

To use the appropriate unit of measurement and language when measuring different objects.

Please find and measure the following objects, refer to the support sheets in order to help you choose the appropriate unit of measurement

How heavy is your shoe? (Please tick the appropriate unit of measurement and measuring device before answering the question).

Weight

Kilogram

gram

Capacity

Litre

millilitre

=

Name-

Date-

Green Group

Learning Objective

To use the appropriate unit of measurement and language when measuring different objects.

Please find and measure the following objects, refer to the support sheets in order to help you choose the appropriate unit of measurement

What is the length of the computer monitor? (Please tick the appropriate unit of measurement and measuring device before answering the question).

Kilometre

Metre

Centimetre

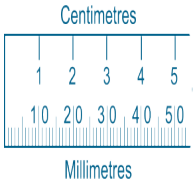

Millimetre

Capacity

Litre

millilitre

[redacted]

[redacted]

Name-

Date-

Green Group

Learning Objective

To use the appropriate unit of measurement and language when measuring different objects.

Please find and measure the following objects, refer to the support sheets in order to help you choose the appropriate unit of measurement

What is the height of the computer monitor? (Please tick the appropriate unit of measurement and measuring device before answering the question).

Kilometre

Metre

Centimetre

Millimetre

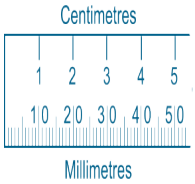

Weight

Kilogram

gram

[redacted]

[redacted]